Rewriting Multiplication Problems (visual)

Name:

Write each array as a multipication problem and solve.

Ex)

1)



2)

3)



4)

5)

6)

7)

8)



9)



10)



11)

Answers

Ex. 4 × 10 = 40

1. _____
2. _____
3. _____
4. _____
5. _____
6. _____
7. _____
8. _____
9. _____
10. _____
11. _____

Rewriting Multiplication Problems (visual) Name: **Answer Key**

Write each array as a multipication problem and solve.

Ex)

1)



2)

3)



4)

5)

6)

7)

8)



9)



10)



11)

Answers

Ex. 4 × 10 = 40

1. 3 × 8 = 24
2. 10 × 7 = 70
3. 7 × 10 = 70
4. 9 × 3 = 27
5. 3 × 3 = 9
6. 5 × 5 = 25
7. 4 × 6 = 24
8. 9 × 7 = 63
9. 2 × 9 = 18
10. 8 × 7 = 56
11. 10 × 3 = 30